Cahier iParcours maths

p 22

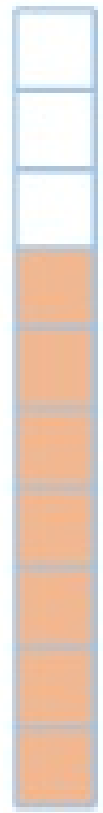

a. $\frac{7}{10}$

10 parts égales

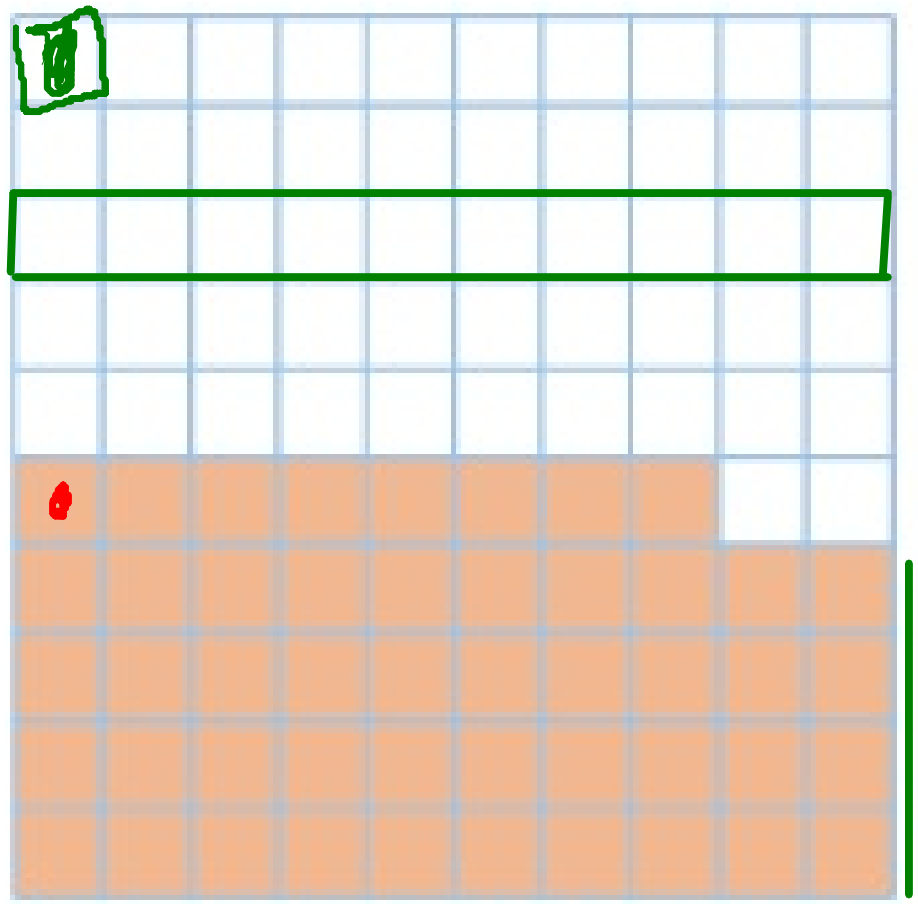

$$\frac{8}{100}$$

b. $\frac{48}{100} = \frac{4}{10} + \frac{8}{100}$

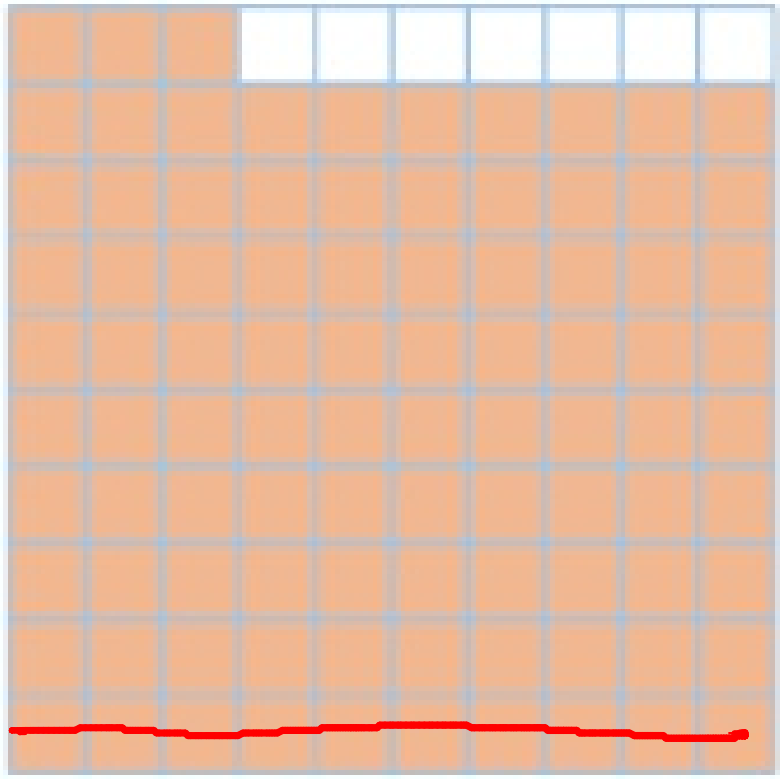

d. $\frac{93}{100} = \frac{9}{10} + \frac{3}{100}$

$\frac{10}{10} = 1$



c. $\frac{19}{10} = 1 + \frac{9}{10}$

$$\frac{100}{100} + \frac{20}{100} = \frac{120}{100}$$

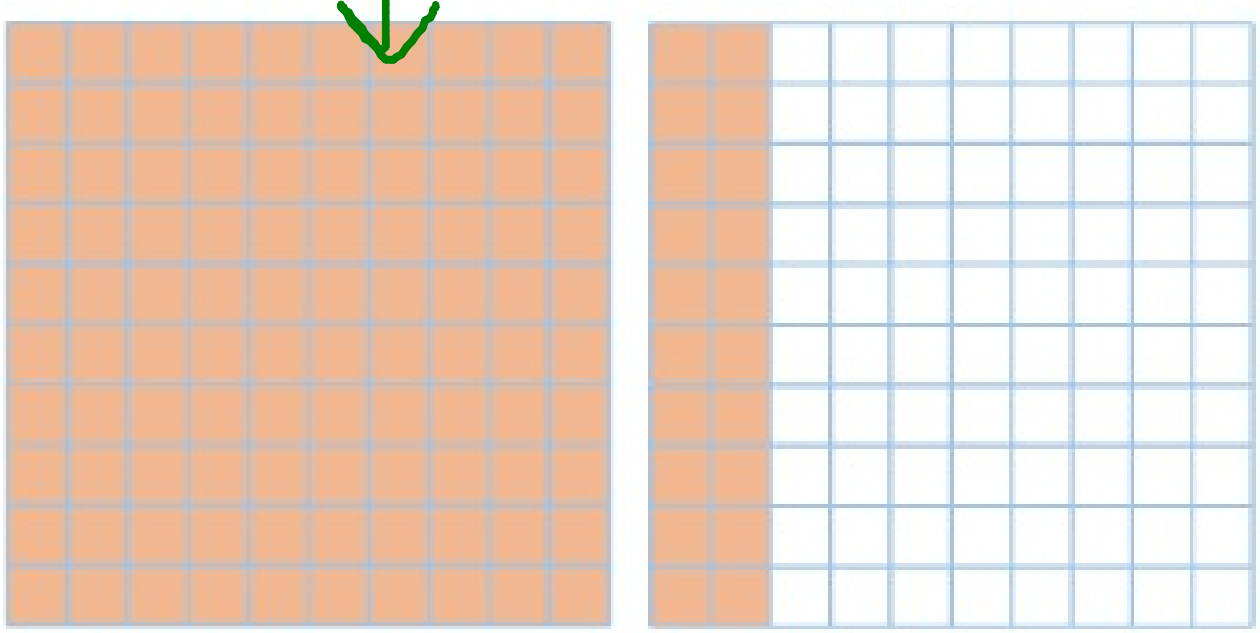

e. $\frac{120}{100} = \frac{12}{10} = 1 + \frac{2}{10}$



f. $\frac{274}{100} = 2 + \frac{74}{100} = 2 + \frac{7}{10} + \frac{4}{100}$

2 Pour chaque figure, colorie la partie qui représente la fraction indiquée puis complète.



a. $\frac{3}{10}$



b. $\frac{77}{100} = \frac{7}{10} + \frac{7}{100}$

$\frac{10}{10} = 1$

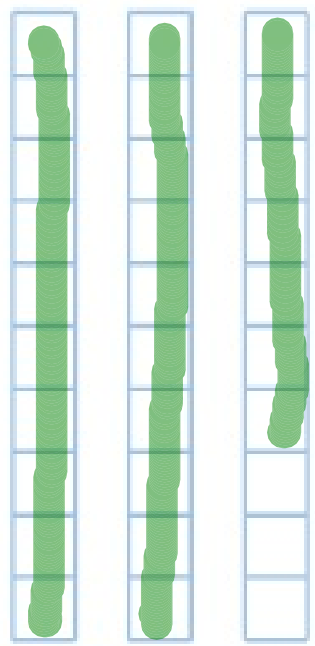

c. $\frac{27}{10} = 2 + \frac{7}{10}$



d. $\frac{9}{10} = \frac{90}{100}$



e. $\frac{143}{100} = 1 + \frac{43}{100} = 1 + \frac{4}{10} + \frac{3}{100}$

1 unité $= \frac{100}{100}$



f. $2 + \frac{6}{10} + \frac{9}{100} = \underset{2}{\ldots\ldots} + \frac{\overset{69}{\ldots\ldots}}{100} = \frac{\overset{269}{\ldots\ldots}}{100}$